Complete the following reactions. Circle the most favored products.

1. 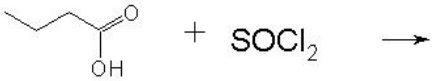

2. 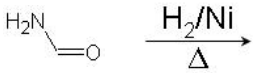

3. 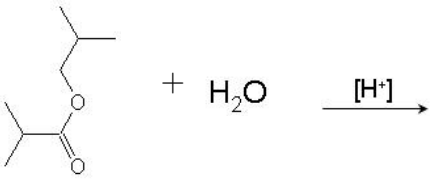

4. 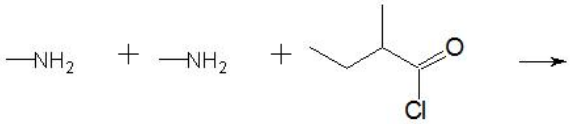

5. 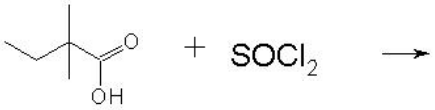

6. 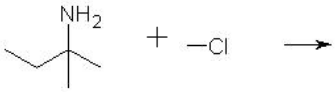

7. 

8. 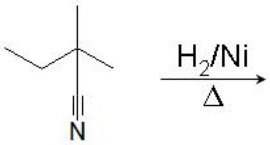

9. 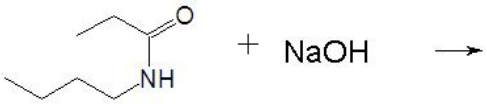

10. 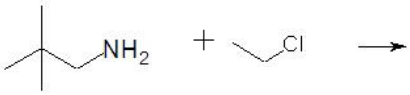

11.

12. 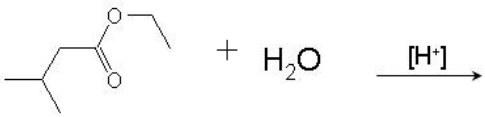

13.

14. 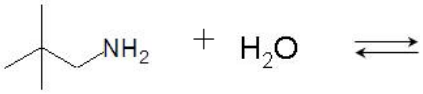

15. 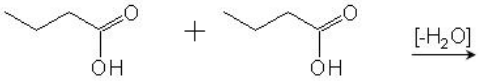

16.

17. 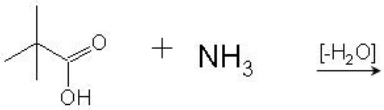

18. 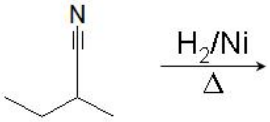

19. 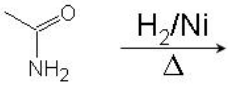

20. 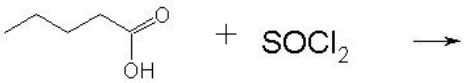

Question 1: 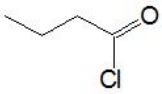 + HCl + SO_2

Question 2: + H_2O

Question 3: 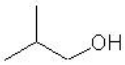 + 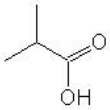

Question 4: 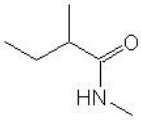 + Cl^-

Question 5: 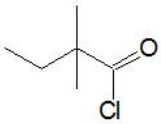 + HCl + SO_2

Question 6: 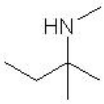 + HCl

Question 7: 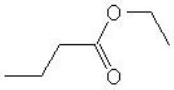 + H_2O

Question 8: 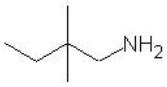

Question 9: 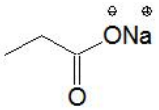 +

Question 10: 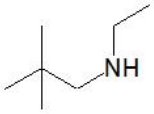 + HCl

Question 11: 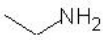 + HCl

Question 12: + 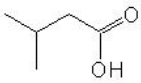

Question 13: 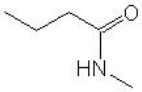 + Cl^-

Question 14: 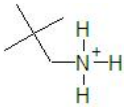 + OH^-

Question 15: 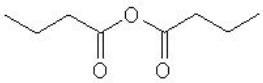 + H_2O

Question 16: 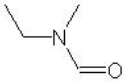 + H_2O

Question 17: 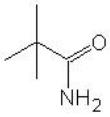 + H_2O

Question 18: 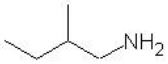

Question 19: 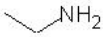 + H_2O

Question 20: 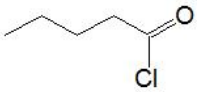 + HCl + SO_2