Complete the following reactions. Circle the most favored products.

1. 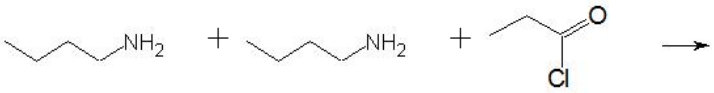

2. 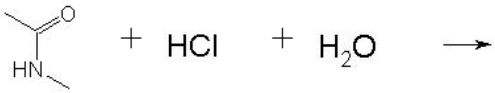

3. 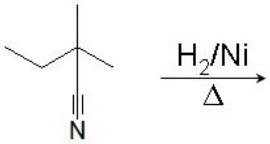

4. 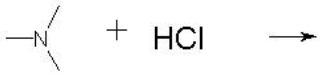

5. 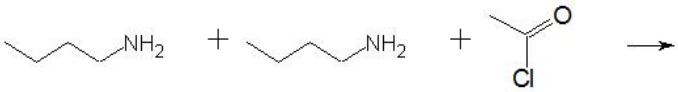

6. 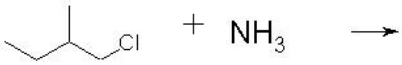

7.

8. 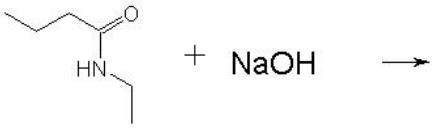

9.

10. 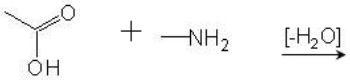

11. 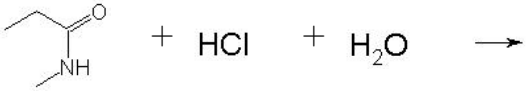

12. + NaOH →

13. 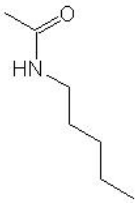 + NaOH →

14. 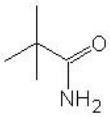 $\xrightarrow[\Delta]{H_2/Ni}$

15. 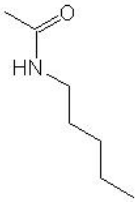 + HCl + H_2O →

16.  + HCl →

17. 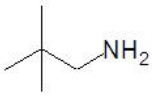 + HCl →

18. 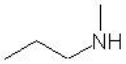 + HCl →

19. 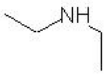 + HCl →

20. $\xrightarrow[\Delta]{H_2/Ni}$

Question 1: 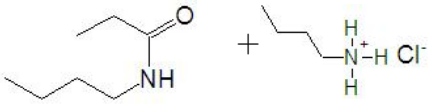

Question 2: 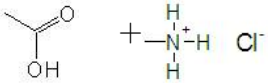

Question 3: 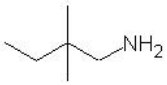

Question 4: 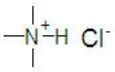

Question 5: 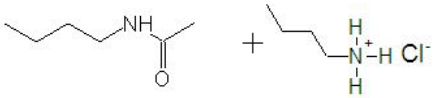

Question 6: 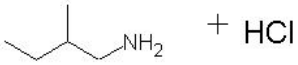

Question 7: 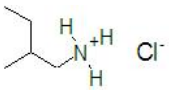

Question 8: 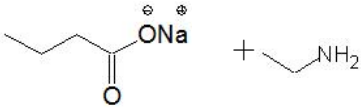

Question 9: 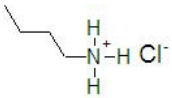

Question 10: 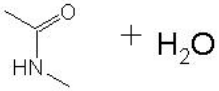

Question 11: 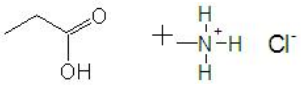

Question 12: 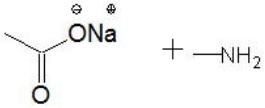

Question 13: 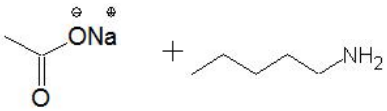

Question 14: 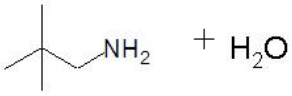

Question 15: 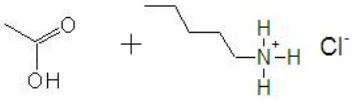

Question 16: 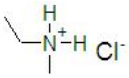

Question 17: 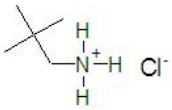

Question 18: 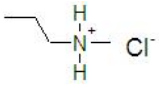

Question 19: 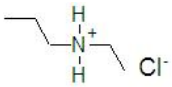

Question 20: